Related facts – Part whole models

1 Use the part–whole diagrams to complete the related facts.

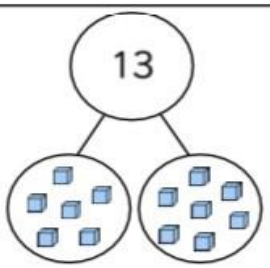

_____ + _____ = 13

_____ + _____ = 13

13 – _____ = _____

13 – _____ = _____

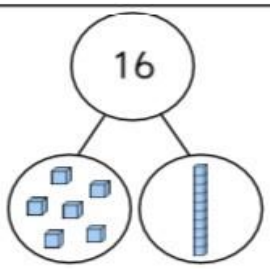

_____ + _____ = 16

_____ + _____ = 16

16 – _____ = _____

16 – _____ = _____

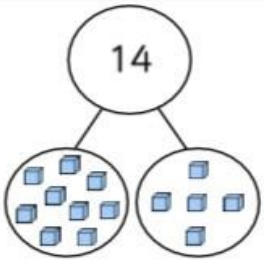

_____ + _____ = 14

_____ + _____ = 14

14 – _____ = _____

14 – _____ = _____

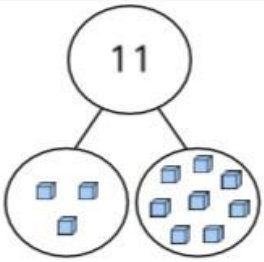

_____ + _____ = 11

_____ + _____ = 11

11 – _____ = _____

11 – _____ = _____

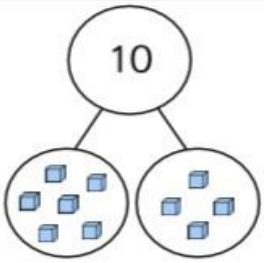

_____ + _____ = 10

_____ + _____ = 10

10 – _____ = _____

10 – _____ = _____

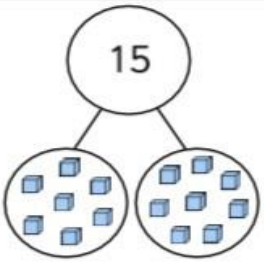

_____ + _____ = 15

_____ + _____ = 15

15 – _____ = _____

15 – _____ = _____

© Primary Stars Education

Related facts – Part whole models

1 Complete the part–whole diagrams to help you complete the related facts.

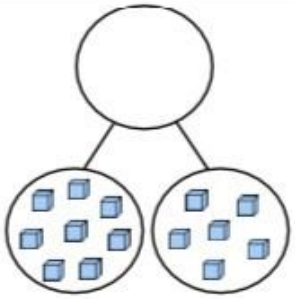

_____ + _____ = _____

_____ + _____ = _____

_____ – _____ = _____

_____ – _____ = _____

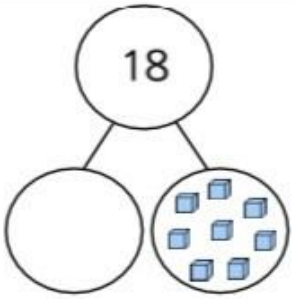

_____ + _____ = _____

_____ + _____ = _____

_____ – _____ = _____

_____ – _____ = _____

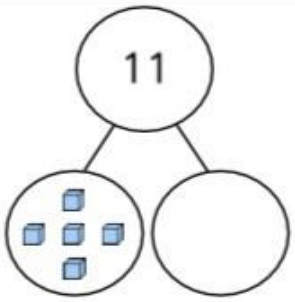

_____ + _____ = _____

_____ + _____ = _____

_____ – _____ = _____

_____ – _____ = _____

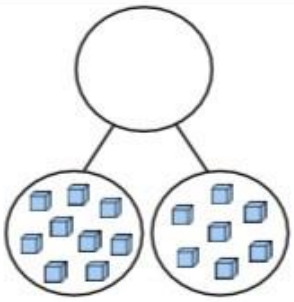

_____ + _____ = _____

_____ + _____ = _____

_____ – _____ = _____

_____ – _____ = _____

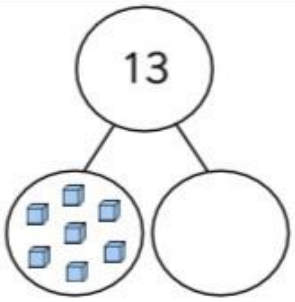

_____ + _____ = _____

_____ + _____ = _____

_____ – _____ = _____

_____ – _____ = _____

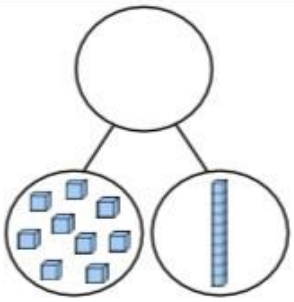

_____ + _____ = _____

_____ + _____ = _____

_____ – _____ = _____

_____ – _____ = _____

© Primary Stars Education